Math Sheet

Name _____ Score _____ Teacher _____ Date _____

Similar Solids

Decide whether each pair is similar or sketch the stated scaled solid. Compare every labelled corresponding length. Rectangular prisms are right, cylinders and cones are right circular solids, and each square-pyramid apex is directly above the base center. Diagrams are not to scale.

1. **Sketch a cone similar to the pictured solid with scale factor 3/2. Label every corresponding dimension. Scale factor: 3/2.**

radius = 54

perpendicular height = 72

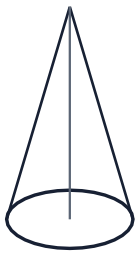

Scaled sketch

2. **Are the two pictured solids similar? Justify using every labelled pair of corresponding lengths.**

length = 48

width = 36

height = 24

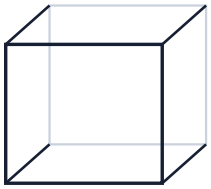

length = 144

width = 108

height = 72

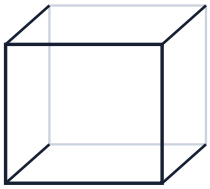

Similar? _____

Name _____ Score _____ Teacher _____ Date _____

Similar Solids

Decide whether each pair is similar or sketch the stated scaled solid. Compare every labelled corresponding length. Rectangular prisms are right, cylinders and cones are right circular solids, and each square-pyramid apex is directly above the base center. Diagrams are not to scale.

3. **Are the two pictured solids similar? Justify using every labelled pair of corresponding lengths.**

base side = 24

perpendicular height = 18

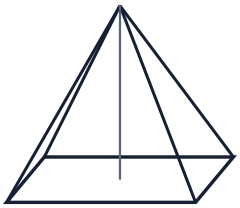

base side = 16

perpendicular height = 13

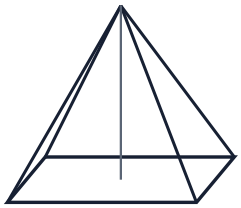

Similar? _____

4. **Sketch a cylinder similar to the pictured solid with scale factor 2/3. Label every corresponding dimension. Scale factor: 2/3.**

radius = 12

height = 30



Scaled sketch

Name _____ Score _____ Teacher _____ Date _____

Similar Solids

Decide whether each pair is similar or sketch the stated scaled solid. Compare every labelled corresponding length. Rectangular prisms are right, cylinders and cones are right circular solids, and each square-pyramid apex is directly above the base center. Diagrams are not to scale.

5. **Sketch a cone similar to the pictured solid with scale factor 2/3. Label every corresponding dimension. Scale factor: 2/3.**

radius = 36

perpendicular height = 48

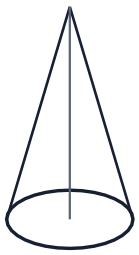

Scaled sketch

6. **Are the two pictured solids similar? Justify using every labelled pair of corresponding lengths.**

radius = 24

height = 60



radius = 16

height = 40



Similar? _____