Math Sheet

Name _____ Score _____ / 10 Teacher _____ Date _____

Read pie charts

Use each pie chart to answer its five questions.

Task 1. Use each pie chart to answer its five questions.

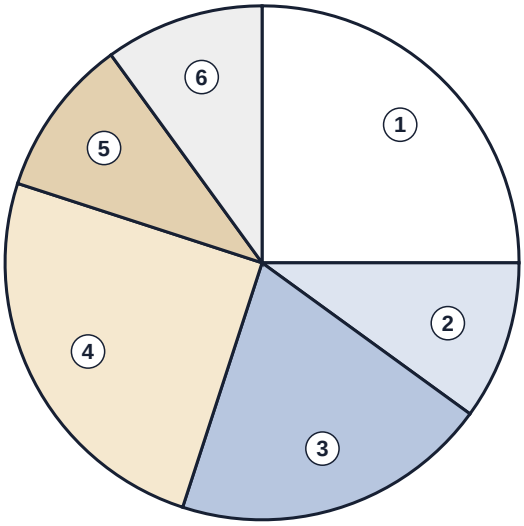

- 1. Apples: 25%
- 2. Books: 10%
- 3. Kites: 20%
- 4. Shells: 25%
- 5. Plants: 10%
- 6. Stars: 10%

1. What percentage belongs to Apples?

2. Which categories have the least value in the chart? List every tied category.

3. Which categories have the greatest value in the chart? List every tied category.

4. What is the total for Books + Kites, in percent?

5. Which two categories total 50%? List every pair that works.

Name _____ Score _____ / 10 Teacher _____ Date _____

Read pie charts

Use each pie chart to answer its five questions.

Task 2. Use each pie chart to answer its five questions.

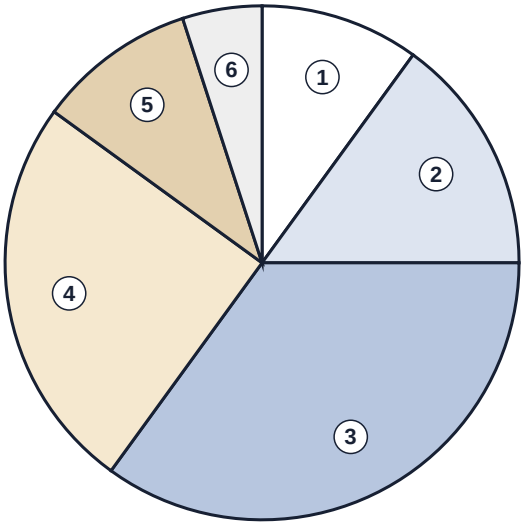

1. Apples: 10%
2. Books: 15%
3. Kites: 35%
4. Shells: 25%
5. Plants: 10%
6. Stars: 5%

1. What percentage belongs to Apples?

2. Which categories have the least value in the chart? List every tied category.

3. Which categories have the greatest value in the chart? List every tied category.

4. What is the total for Books + Kites, in percent?

5. Which two categories total 50%? List every pair that works.

Name _____ Score _____ / 10 Teacher _____ Date _____

Read pie charts - Answer key

Use each pie chart to answer its five questions.

Task 1. Use each pie chart to answer its five questions.

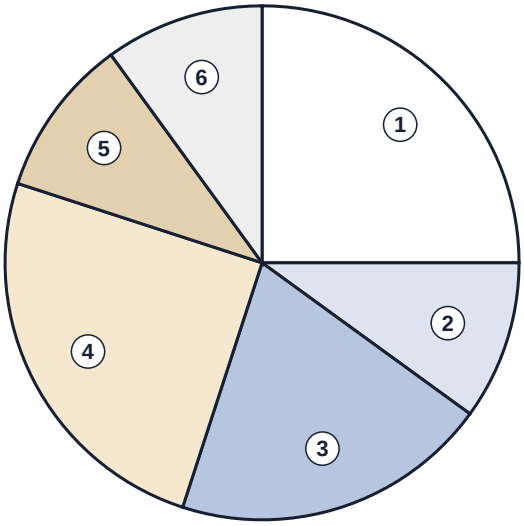

1. Apples: 25%
2. Books: 10%
3. Kites: 20%
4. Shells: 25%
5. Plants: 10%
6. Stars: 10%

1. What percentage belongs to Apples?

   Answer: 25%

2. Which categories have the least value in the chart? List every tied category.

   Answer: Books, Plants, Stars

3. Which categories have the greatest value in the chart? List every tied category.

   Answer: Apples, Shells

4. What is the total for Books + Kites, in percent?

   Answer: 30%

5. Which two categories total 50%? List every pair that works.

   Answer: Apples + Shells

Name _____ Score _____ / 10 Teacher _____ Date _____

Read pie charts - Answer key

Use each pie chart to answer its five questions.

Task 2. Use each pie chart to answer its five questions.

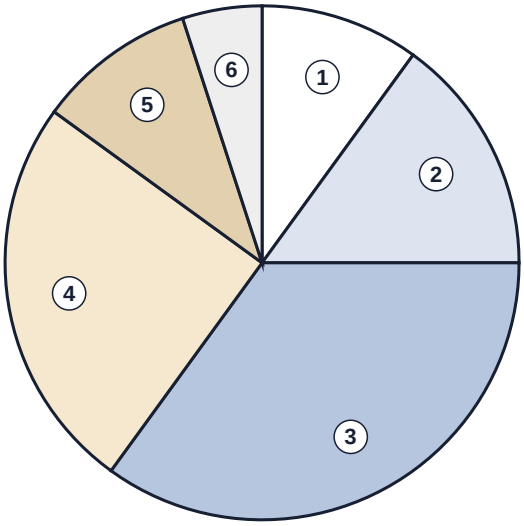

1. Apples: 10%
2. Books: 15%
3. Kites: 35%
4. Shells: 25%
5. Plants: 10%
6. Stars: 5%

1. What percentage belongs to Apples?

   Answer: 10%

2. Which categories have the least value in the chart? List every tied category.

   Answer: Stars

3. Which categories have the greatest value in the chart? List every tied category.

   Answer: Kites

4. What is the total for Books + Kites, in percent?

   Answer: 50%

5. Which two categories total 50%? List every pair that works.

   Answer: Books + Kites